Grade 2 daily math review

NAME	DATE	SCORE / 6

DAY 1 Answer each question.

1 Which fraction is larger, $\frac{1}{12}$ or $\frac{1}{2}$, and why?

- ○ They are the same size, because both have 1 on top.
- ○ $\frac{1}{2}$ is larger, because fewer equal parts make bigger parts.
- ○ $\frac{1}{12}$ is larger, because 12 is more than 2.

2 The graph shows the fruit each child chose. How many children chose Plum?

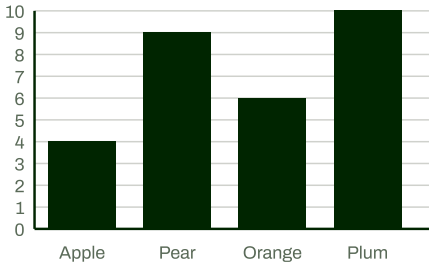

3 A bar is measured on the ruler below. How many inches long is the bar?

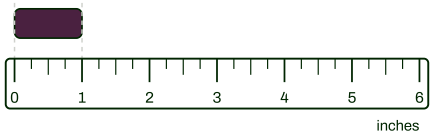

4 Write the next three numbers in this pattern.

99, 93, 87, 81, ☒, ☒, ☒

5 Count the coins below. How many cents are there altogether?

6 Is this equation true or false?

12 – 5 = 13 – 6

○ True ○ False

Grade 2 daily math review

NAME	DATE	SCORE / 6

DAY 2 Answer each question.

7 Look at the shape below. What fraction of the shape is shaded?

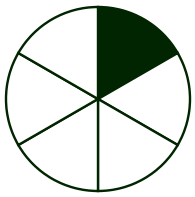

$\frac{\square}{\square}$

8 13 – 4 = ?

☐

9 A spinner has 2 yellow parts and 6 green parts, all the same size. Ana spins the spinner once. Is landing on red certain, possible or impossible?

◯ Certain ◯ Possible ◯ Impossible

10 Which unit is best for a bus's length?

◯ Feet ◯ Inches ◯ Miles

11 Look at the row of shapes. Counting from the left, where is the triangle?

◯ First ◯ Second ◯ Third

12 What number goes in the box?

17 – 9 = 17 – 7 – ☐

☐

Grade 2 daily math review

NAME	DATE	SCORE / 6

DAY 3 Answer each question.

13 Which sign goes in the box? 484 ☐ 537

○ < ○ > ○ =

14 Shape 1 below was moved to make shape 2. Was shape 1 slid, flipped or turned?

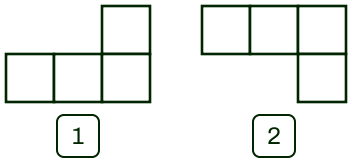

○ Slid ○ Flipped ○ Turned

15 The 10 dots below are in 2 equal rows. What fraction of all the dots do 5 dots make?

Row 1

Row 2



$\frac{\square}{\square}$

16 Write the next three numbers in this pattern.

92, 100, 108, 116, ☐, ☐, ☐

17 Is this number sentence true or false?

19 = 19

○ True ○ False

18 Count the coins below. How many cents are there altogether?

Grade 2 daily math review

NAME	DATE	SCORE / 6

DAY 4 Answer each question.

19 10 + 88 = ?

20 The graph shows the pet each child chose. How many children chose Cat?

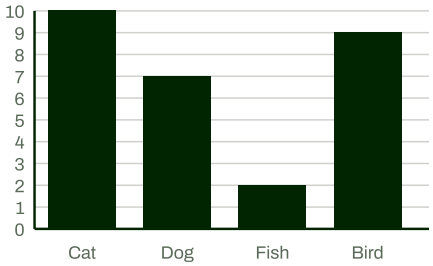

21 6 + ☒ = 11

22 Look at the shape below. What fraction of the shape is shaded?

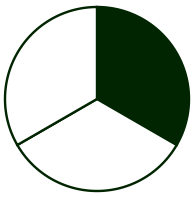

23 7 + 4 + 6 = ?

24 The graph shows the pet each child chose. How many fewer children chose Fish than Dog?

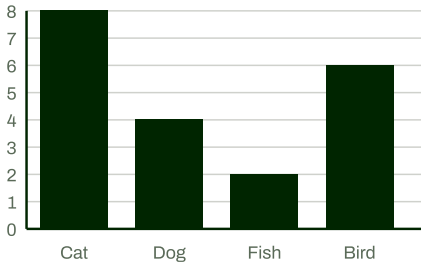

Grade 2 daily math review

NAME	DATE	SCORE / 6

DAY 5 Answer each question.

25 Which sign goes in the box? 592 ☐ 952

◯ < ◯ > ◯ =

26 Write the next three numbers in this pattern.

69, 72, 75, 78, ☐, ☐, ☐

27 68 + 38 + 59 + 56 = ?

28 A bar is measured on the ruler below. How many centimeters long is the bar?

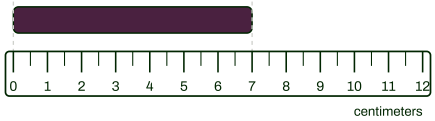

29 Maya cannot move the desk or bench. A ribbon is as long as the desk. The ribbon is shorter than the bench. Which is shorter, the bench or the desk?

◯ The bench ◯ The desk

30 What number is ten more than 25?

Grade 2 daily math review

1	$\frac{1}{2}$ is larger, because fewer equal parts make bigger parts.	2	10	3	1
4	75, 69, 63	5	70	6	True
7	$\frac{1}{6}$	8	9	9	Impossible
10	Feet	11	First	12	2
13	<	14	Flipped	15	$\frac{1}{2}$
16	124, 132, 140	17	True	18	30
19	98	20	10	21	5
22	$\frac{1}{3}$	23	17	24	2
25	<	26	81, 84, 87	27	221
28	7	29	The desk	30	35