GRADE 2 · SPATIAL AND GEOMETRIC REASONING

Identify a right angle as a square corner

NAME	DATE	SCORE / 10

1 Which angle below is a right angle? Circle it.

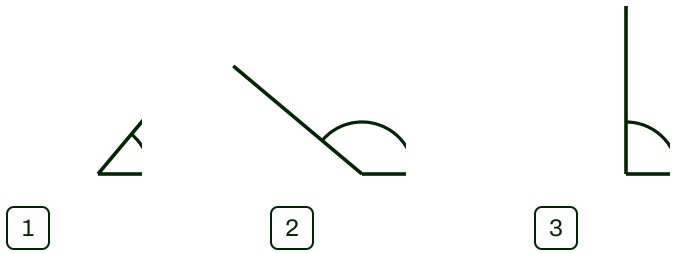

2 A shape is drawn on the grid below. The corners of the grid squares are right angles. How many right angles does the shape have?

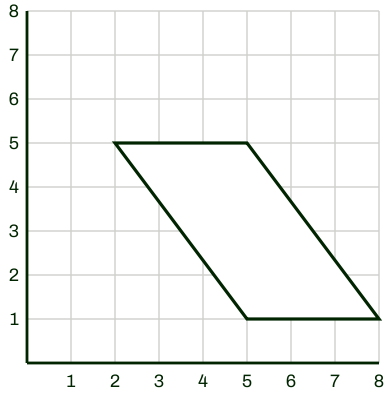

3 Is the angle below a right angle?



◯ Yes ◯ No

4 A shape is drawn on the grid below. The corners of the grid squares are right angles. How many right angles does the shape have?

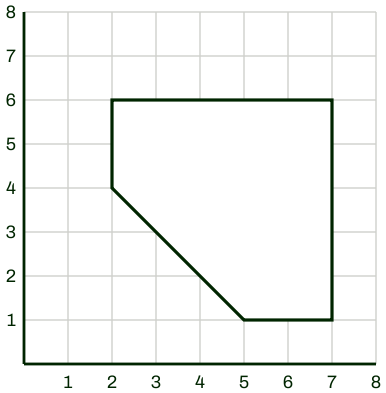

5 Is the angle below a right angle?

◯ Yes ◯ No

6 A shape is drawn on the grid below. The corners of the grid squares are right angles. How many right angles does the shape have?

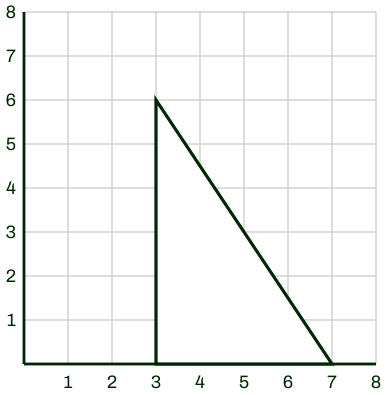

7 Which angle below is a right angle? Circle it.



1 2 3

8 A shape is drawn on the grid below. The corners of the grid squares are right angles. How many right angles does the shape have?

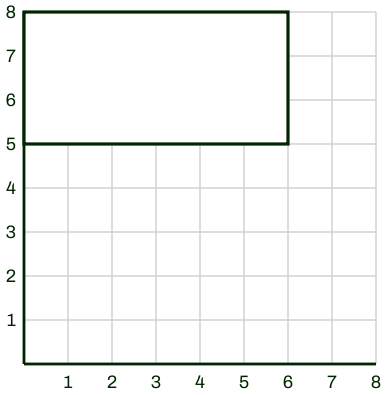

9 Which angle below is a right angle? Circle it.

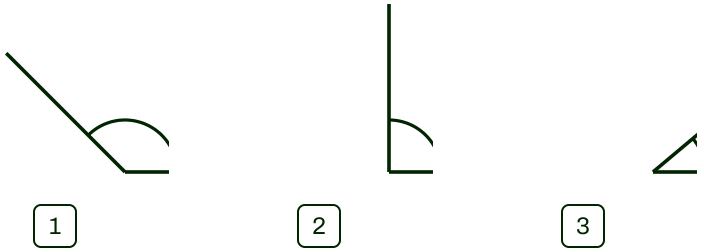

10 A shape is drawn on the grid below. The corners of the grid squares are right angles. How many right angles does the shape have?

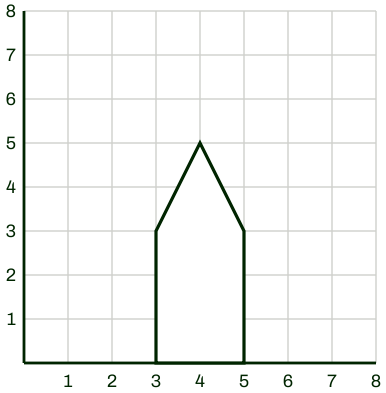

ANSWER KEY · GRADE 2 · SPATIAL AND GEOMETRIC REASONING

Identify a right angle as a square corner

1	3	2	0
3	No	4	3
5	Yes	6	1
7	1	8	4
9	2	10	2