GRADE 2 · SPATIAL AND GEOMETRIC REASONING

# Identify a right angle as a square corner

| NAME | DATE | SCORE / 10 |
|---|---|---|
| | | |

**1** Is the angle below a right angle?

◯ Yes ◯ No

**2** A shape is drawn on the grid below. The corners of the grid squares are right angles. How many right angles does the shape have?

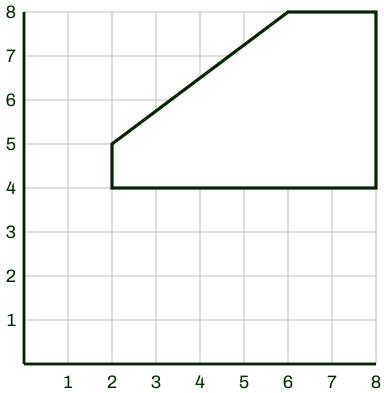

**3** Which angle below is a right angle? Circle it.

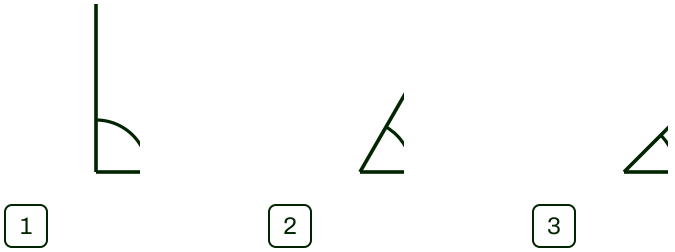


**4** A shape is drawn on the grid below. The corners of the grid squares are right angles. How many right angles does the shape have?

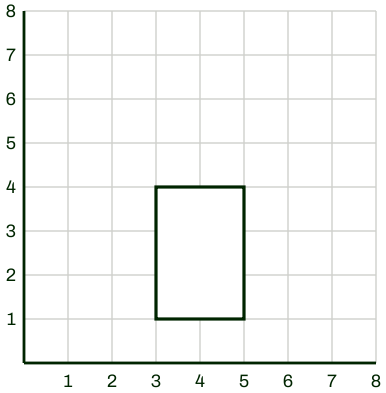


**5** Is the angle below a right angle?

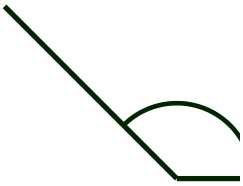

◯ Yes ◯ No

**6** A shape is drawn on the grid below. The corners of the grid squares are right angles. How many right angles does the shape have?

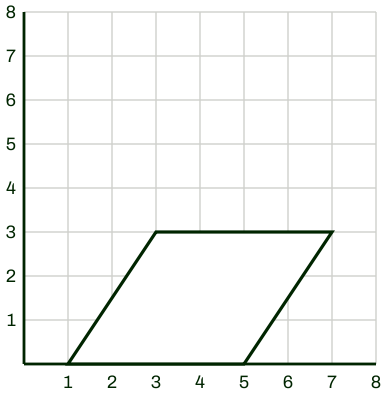


**7** Which angle below is a right angle? Circle it.

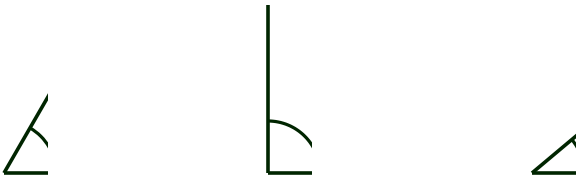

1 2 3

**8** A shape is drawn on the grid below. The corners of the grid squares are right angles. How many right angles does the shape have?

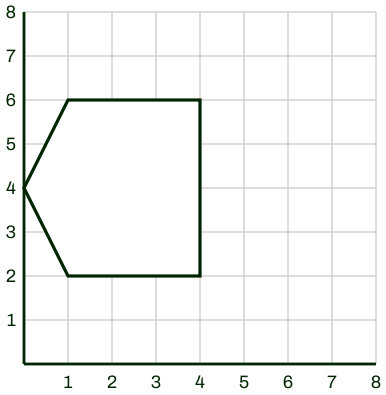

**9** Which angle below is a right angle? Circle it.



1 2 3

**10** A shape is drawn on the grid below. The corners of the grid squares are right angles. How many right angles does the shape have?

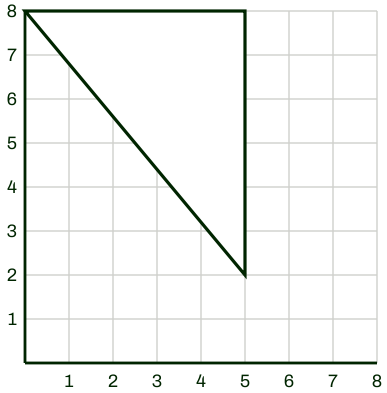

ANSWER KEY · GRADE 2 · SPATIAL AND GEOMETRIC REASONING

# Identify a right angle as a square corner

| | | | |
|---|---|---|---|
| 1 | Yes | 2 | 3 |
| 3 | 1 | 4 | 4 |
| 5 | No | 6 | 0 |
| 7 | 2 | 8 | 2 |
| 9 | 3 | 10 | 1 |